WIG 5 blok 6

Rekenen:
Rekenrek: maak de 5 som en draai de som om.
Geld: maak de 5 som en draai de som om.
+5 sommen werkblad.
-5 sommen werkblad.
Verstopte 5 sommen: maak de som af.
Welk som hoort erbij? - sommen.
Verdeel de sterren in 10 en de rest.
Hoeveel eieren zie je?
Hoeveel sterren zie je samen? Maak de som!
Verdwijnsommen.
Bijna-verdwijnsommen.
Spelbord bijna-verdwijnsommen en verdwijnsommen.
Hoeveel op het rekenrek?
Zet een streepje bij het juiste aantal kralen op het rekenrek.
Zet de sterren in de juiste volgorde van klein naar groot.
Kleur de grootste planeet!
Twee spellen bij het 100-veld.
Domino: hoeveel is het samen? Maak de som.
Domino: pak een steen, teken en maak de som!
Tellen met sprongen: 2 even, 2 oneven, 5 en 10.
Getallenlijn tot en met 100: vul de sterren in.
Maak de dubbelsommen (herhaling)+ hogere dubbelsommen.
+2, -2 sommen maken (herhaling).
Verliefde harten.
Maak de verschillende type sommen in de tabel.
Kleur de sterren in: de verliefde harten en dubbelsommen.
Zoek het juiste antwoord bij de som, trek een lijntje.
Splitsen van 10: verschillende werkbladen.
Hoeveel moet je betalen? Zet rondjes om het juiste bedrag.
Splitsen van 5,6,7,8 en 9.
Splitsen van 10: spelborden.
De raket stijgt bijna op! Zoek de halve uren.
Een uur later en een uur vroeger.
Splitsspeurtocht: hoeveel sterren zweven er achter de maan?
Splitsspeurtocht: hoeveel astronauten stappen er uit de raket?



Maak de 5-som en draai de som om.

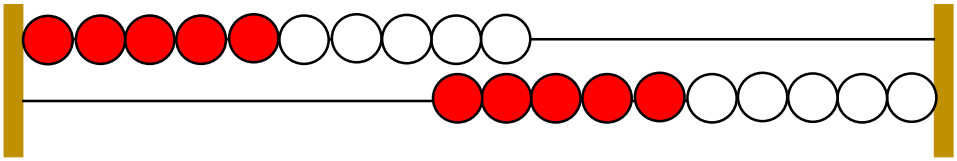

5+ =

+5 =

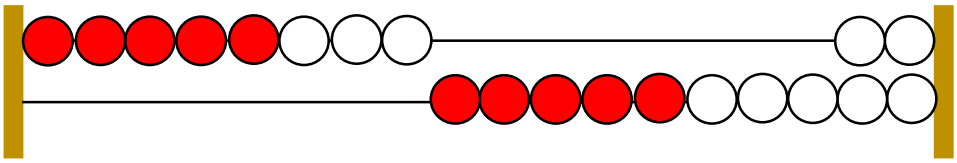

5+ =

+5 =

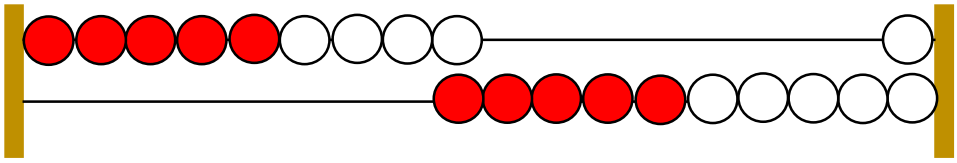

5+ =

+5 =

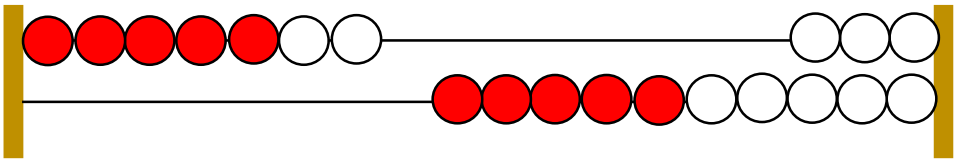

5+ =

+5 =

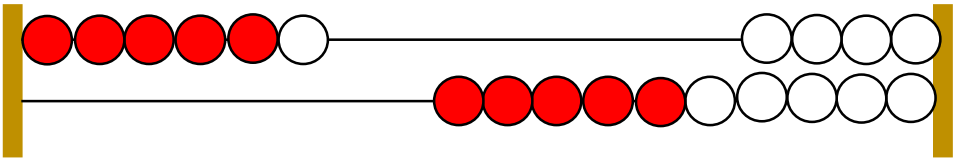

5+ =

+5 =

Maak de 5-som en draai de som om.

5+ =

+5 =

5+ =

+5 =

5+ =

+5 =

5+ =

+5 =

5+ =

+5 =



Lisanne van den Belt

+ 5 sommen.

0+5=	5+3=	5+3=	5+4=
5+0=	3+5=	5+5=	2+5=
5+1=	5+4=	5+4=	3+5=
1+5=	4+5=	5+2=	5+2=
5+2=	5+5=	3+5=	3+5=
2+5=	5+1=	1+5=	5+1=

Bedenk zelf rijtjes met 5 sommen.

....+5=	....+5=
5+....=	5+....=
....+5=	....+5=
5+....=	5+....=

Kleur de 5 sommen.

5+1	5+5	7+1	3+5	4+5
4+1	2+5	5+4	5+3	5+5

– 5 sommen.

7–5=	9–5=	7–2=	7–5=
7–2=	9–4=	6–1=	8–5=
6–1=	10–5=	5–0=	9–5=
6–5=	5–5=	8–3=	10–5=
8–5=	5–0=	9–4=	6–5=
8–3=	9–5=	10–5=	5–5=

Bedenk zelf rijtjes met 5 sommen.

....–5=	....–5=
5–....=	5–....=
....–5=	....–5=
5–....=	5–....=

Kleur de 5 sommen.

5–1	5–5	7–1	8–5	7–5
4–1	6–1	9–4	8–3	5–5

5 sommen.

0+ ★ =5

5+0= ★

★ +1=6

1+ ★ =6

★ +2=7

★ +5=7

5+ ★ =8

5+5= ★

5+ ★ =9

5+ ★ =7

★ +5=8

1+5= ★

5− ★ =5

5−0= ★

★ −1=5

6− ★ =5

★ −5=3

★ −5=2

5− ★ =4

5−5= ★

9− ★ =5

8− ★ =3

★ −5=1

9−5= ★

Zoek de 5 sommen

☐ 8−5	☐ 9−5	☐ 9−3	☐ 8−3
☐ 10−3	☐ 9−4	☐ 8−3	☐ 6−5
☐ 7−5	☐ 7−2	☐ 10−5	☐ 9−5
☐ 6−4	☐ 6−1	☐ 7−2	☐ 4−1

Welke som hoort erbij?

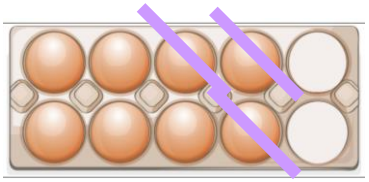

_ – _ = _

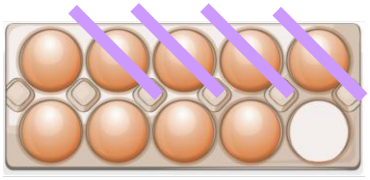

_ – _ = _

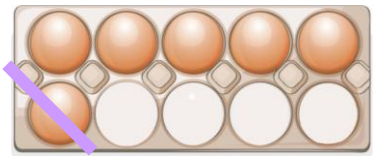

_ – _ = _

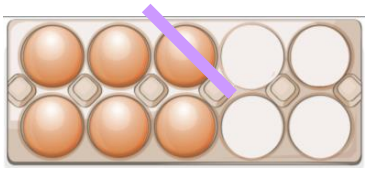

_ – _ = _

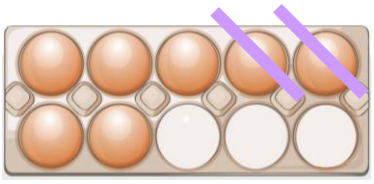

_ – _ = _

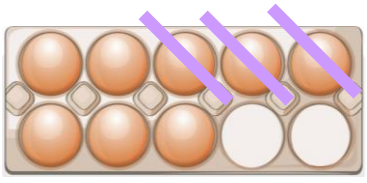

_ – _ = _

Verdeel de sterren in 10 en de rest...



?

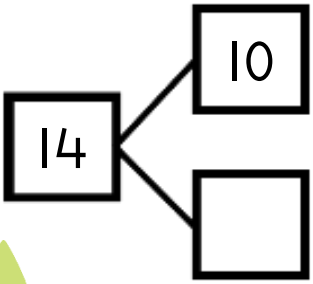

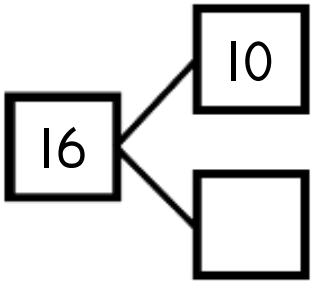

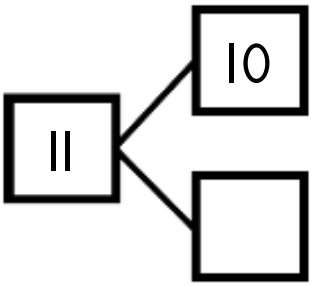

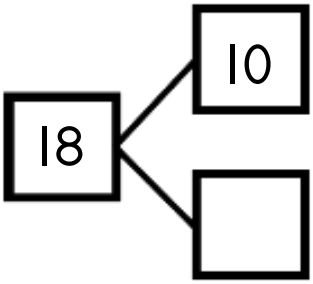

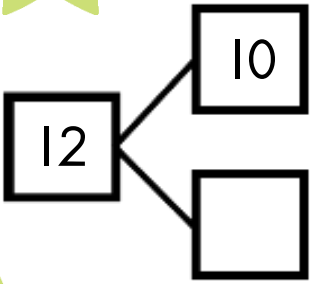

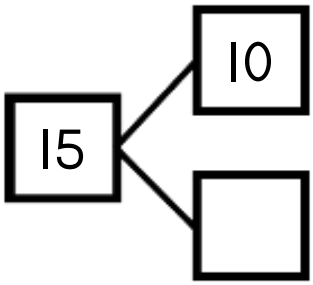

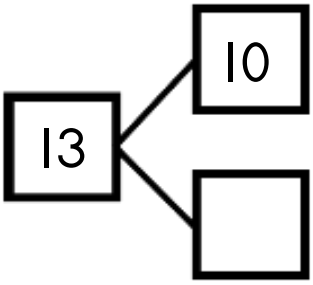

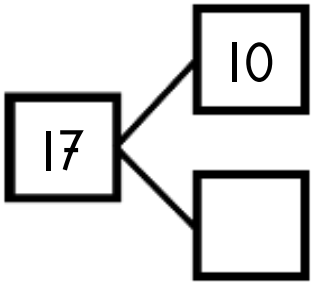

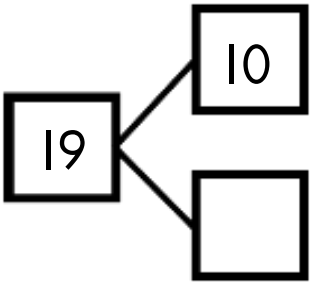

Hoeveel eieren zie je?

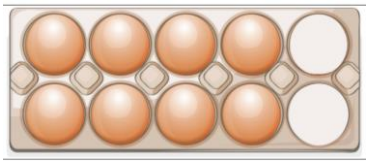

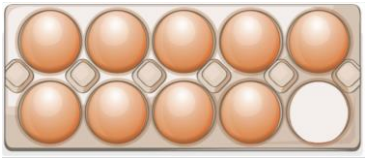



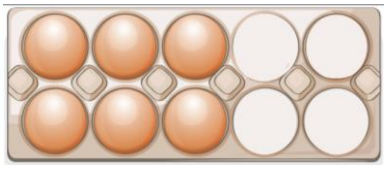





Lisanne van den Belt

Welke som hoort erbij? Maak deze...

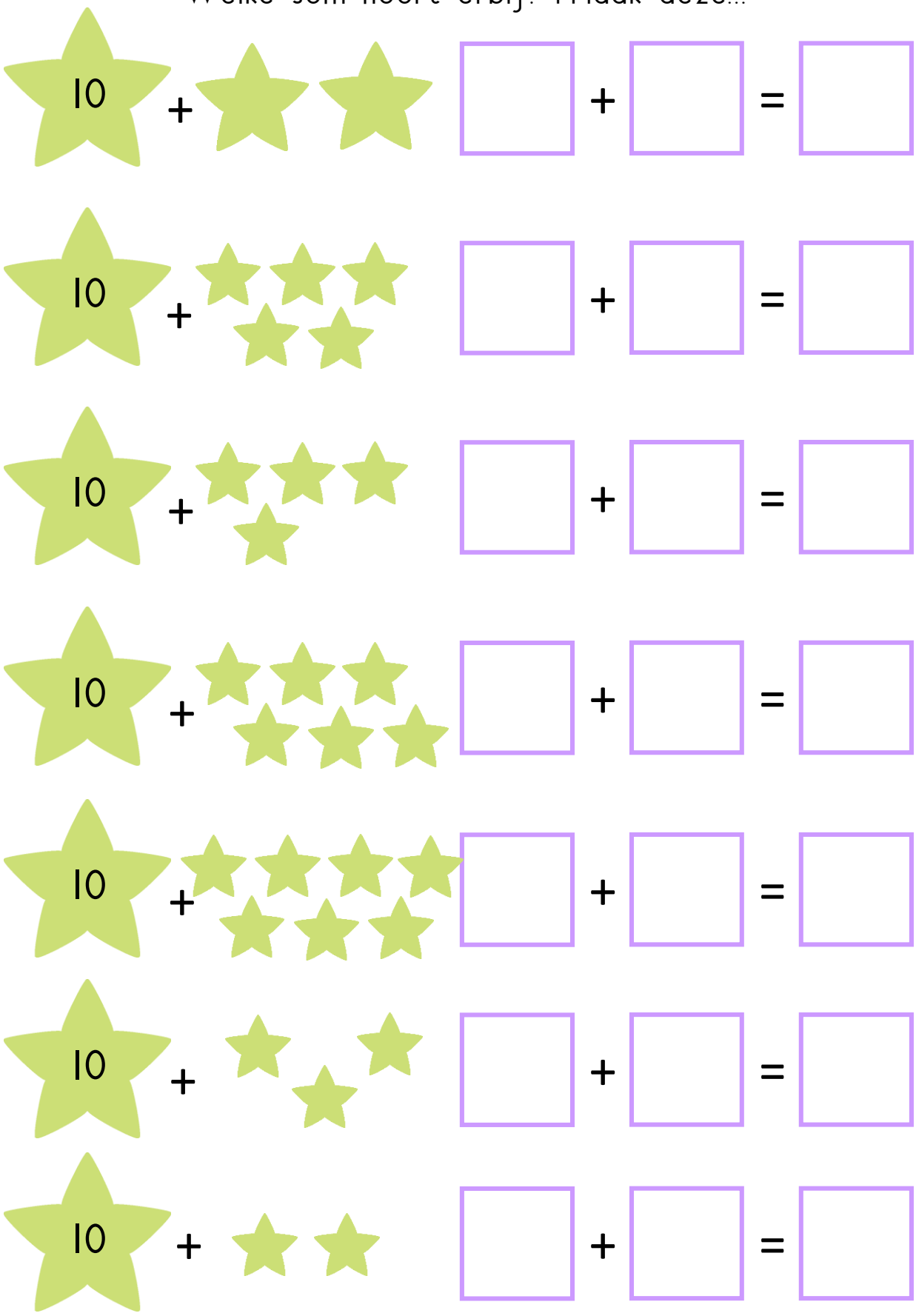

Lisanne van den Belt

Verdwijnsommen



3−3=0

.....−.....=0

.....−.....=0

.....−.....=0

.....−.....=0

- ☐ 3−3=
- ☐ 2−2=
- ☐ 4−4=
- ☐ 5−5=
- ☐ 8−8=

- ☐ 9−9=
- ☐ 6−6=
- ☐ 0−0=
- ☐ 1−1=
- ☐ 7−7=

- ☐ 3−3=
- ☐ 5−5=
- ☐ 8−8=
- ☐ 10−10=
- ☐ 6−6=

Bijna-verdwijnsommen

3−2=1

.....−.....=1

.....−.....=1

.....−.....=1

.....−.....=1

- [ ] 3−2=
- [ ] 2−1=
- [ ] 4−3=
- [ ] 5−4=
- [ ] 8−7=

- [ ] 9−8=
- [ ] 6−5=
- [ ] 1−0=
- [ ] 2−1=
- [ ] 7−6=

- [ ] 3−2=
- [ ] 5−4=
- [ ] 8−7=
- [ ] 10−9=
- [ ] 6−5=

Bijna-verdwijnsommen en verdwijnsommen.

start	5-5	6-5	4-3	4-4	5-4
					9-8
7-7	4-3	2-1	6-6	9-9	8-7
3-3					
7-6	3-2	9-8	8-7	4-4	10-9
					8-8
7-6	8-7	3-2	10-10	2-2	1-1
8-8					
5-4	2-1	4-3	5-5	6-5	7-6
					einde

Lisanne van den Belt

Hoeveel staat er op het rekenrek?

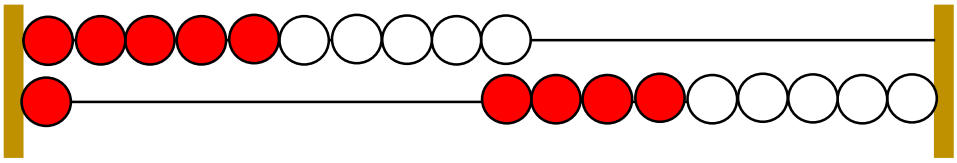

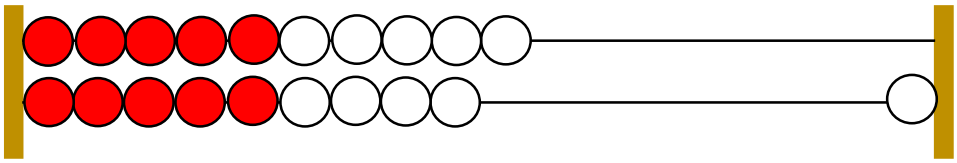

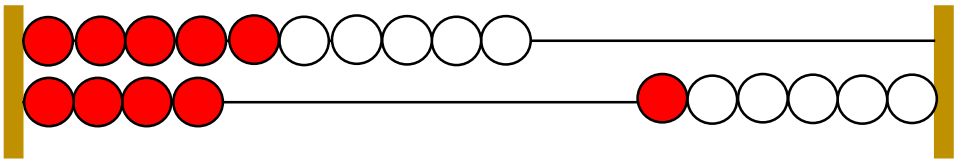

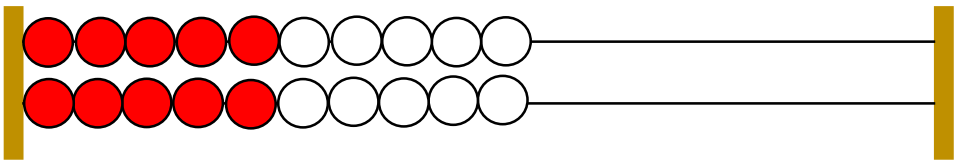

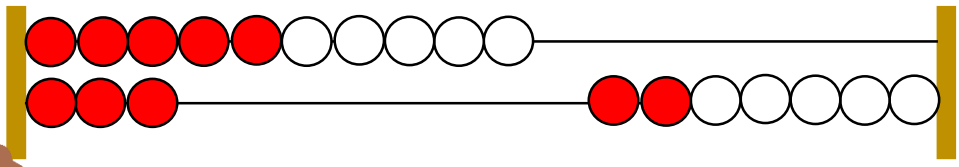

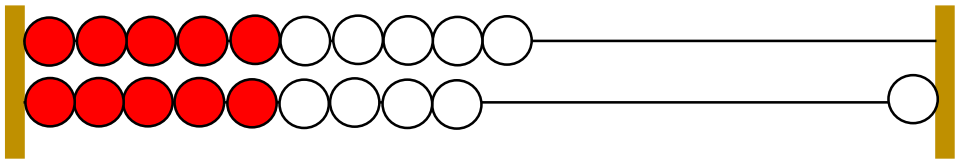

Zet een streepje bij het juiste aantal kralen!

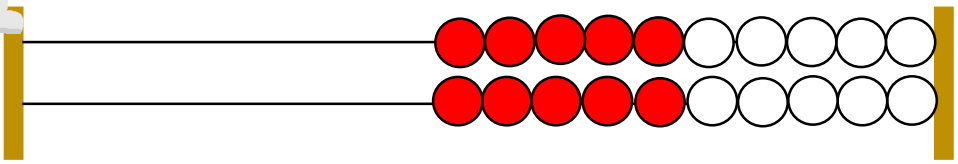

13

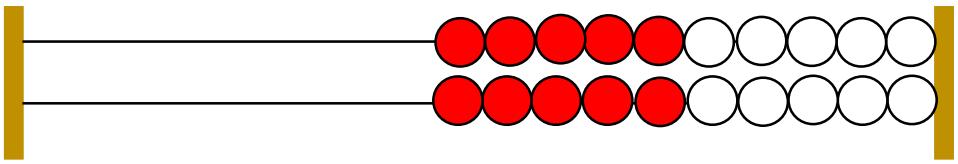

16

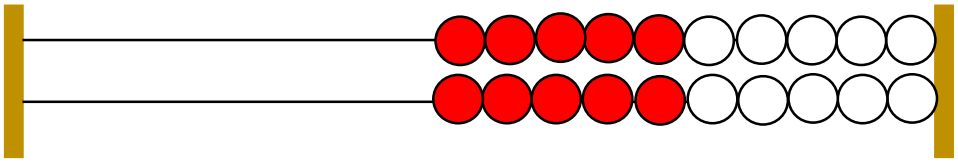

18

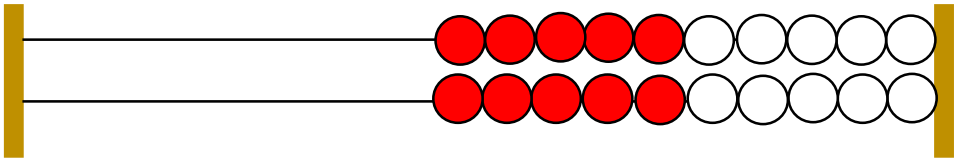

11

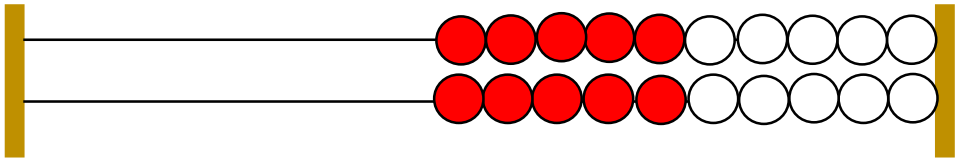

20

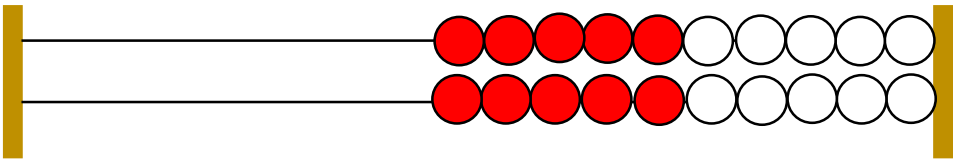

15

Zet een streepje bij het juiste aantal kralen!

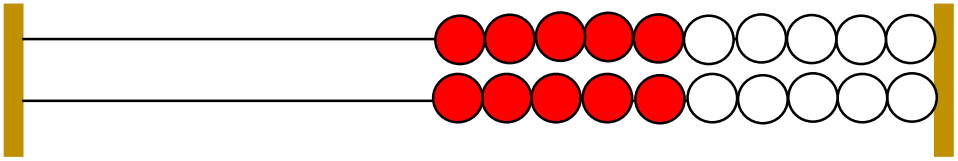

14

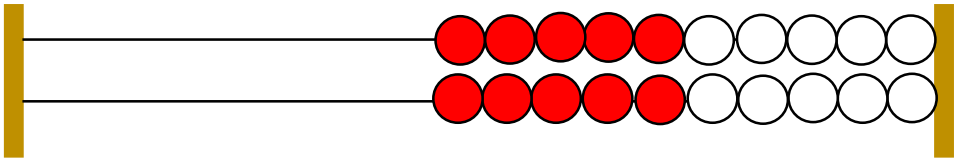

12

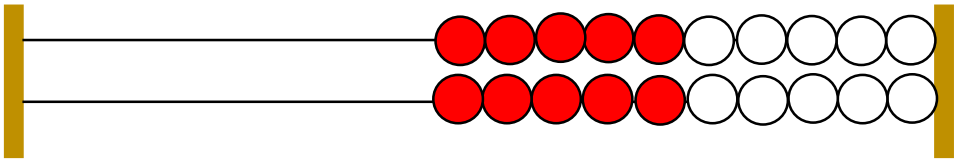

19

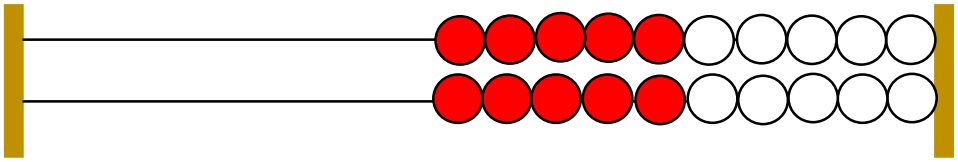

16

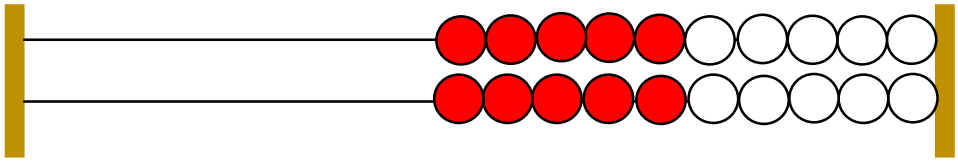

17

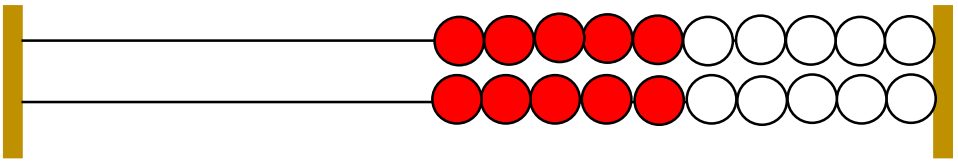

20

Zet jij de sterren in de juiste volgorde?



Lisanne van den Belt

Zet jij de sterren in de juiste volgorde?



Lisanne van den Belt

Kleur de planeet met het grootste getal.

75 79

98 89

31 34

65 78

23 32

87 91

12 21

67 76

Kleur de planeet met het grootste getal.

44 66

53 35

78 54

99 98

76 34

55 59

81 18

47 74

1	2	3	4	5	6	7	8	9	10
11	12	13	14	15	16	17	18	19	20
21	22	23	24	25	26	27	28	29	30
31	32	33	34	35	36	37	38	39	40
41	42	43	44	45	46	47	48	49	50
51	52	53	54	55	56	57	58	59	60
61	62	63	64	65	66	67	68	69	70
71	72	73	74	75	76	77	78	79	80
81	82	83	84	85	86	87	88	89	90
91	92	93	94	95	96	97	98	99	100

1. Pak 3 verschillende getalkaartjes tot en met 100.
2. Leg ze in de juiste volgorde van klein naar groot.
3. Kleur de getallen in op het 100-veld.
4. Kun jij het hele veld vol kleuren?

Succes!



1	2	3	4	5	6	7	8	9	10
11	12	13	14	15	16	17	18	19	20
21	22	23	24	25	26	27	28	29	30
31	32	33	34	35	36	37	38	39	40
41	42	43	44	45	46	47	48	49	50
51	52	53	54	55	56	57	58	59	60
61	62	63	64	65	66	67	68	69	70
71	72	73	74	75	76	77	78	79	80
81	82	83	84	85	86	87	88	89	90
91	92	93	94	95	96	97	98	99	100

1. Pak een getalkaartje tot en met 100.
2. Kleur het getal in op het 100-veld.
3. Kleur ook de buurgetallen van dit getal in het 100-veld.
4. Kun jij het hele veld vol kleuren?

Succes!



Hoeveel is het samen? Maak de som!



___ + ___ = ___



___ + ___ = ___



___ + ___ = ___



___ + ___ = ___



___ + ___ = ___



___ + ___ = ___



___ + ___ = ___



___ + ___ = ___



Hoeveel is het samen? Maak de som!

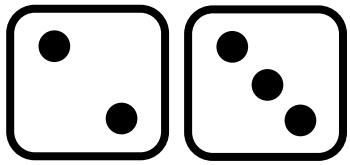 ☐ + ☐ = ☐

 ☐ + ☐ = ☐

 ☐ + ☐ = ☐

 ☐ + ☐ = ☐

 ☐ + ☐ = ☐

 ☐ + ☐ = ☐

 ☐ + ☐ = ☐

 ☐ + ☐ = ☐



Pak de dominostenen en maak de som!

			+		=	
			+		=	
			+		=	
			+		=	
			+		=	
			+		=	
			+		=	
			+		=	

Pak de dominostenen en maak de som!

			+		=	
			+		=	
			+		=	
			+		=	
			+		=	
			+		=	
			+		=	
			+		=	



We springen over de planeten met sprongen van 2.
Maak de rij af!

	10				18	
	12			18		
	2					
	8		12			
					14	
	12					
			14			

We springen over de planeten met sprongen van 2.
Maak de rij af!

	3				11	
	1			7		
	5					
			15			
		9			15	
	1					
			13			

We springen over de planeten met sprongen van **5**.
Maak de rij af!

	5				25	
	0					
	15					
			25			
					15	
	20					
			10			

We springen over de planeten met sprongen van 10.
Maak de rij af!

	10					
	0					
	30					
			70			
					60	
	20					
			40			

Vul de sterren met het juiste getal.

34				38
56				60
77				81
22				26
88				92
67				71
94				98

Vul de sterren met het juiste getal.

34				38
56				60
77				81
22				26
88				92
67				71
94				98

Maak de dubbelsommen!

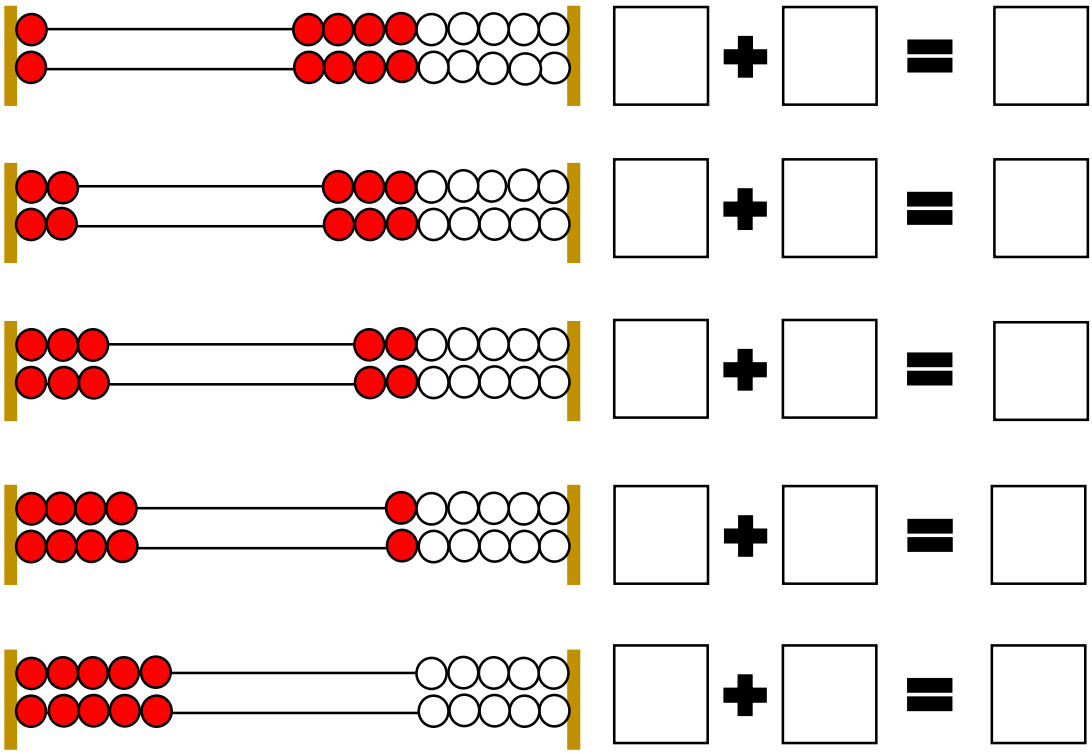

0+0=	4+4=	3+3=	2+2=
1+1 =	0+0=	5+5=	0+0=
2+2=	2+2=	2+2=	2+2=
3+3=	5+5=	5+5=	5+5=
4+4=	4+4=	4+4=	4+4=
5+5=	3+3=	1+1 =	3+3=
6+6=	7+7=	8+8=	9+9=

Lisanne van den Belt

Maak de dubbelsommen!

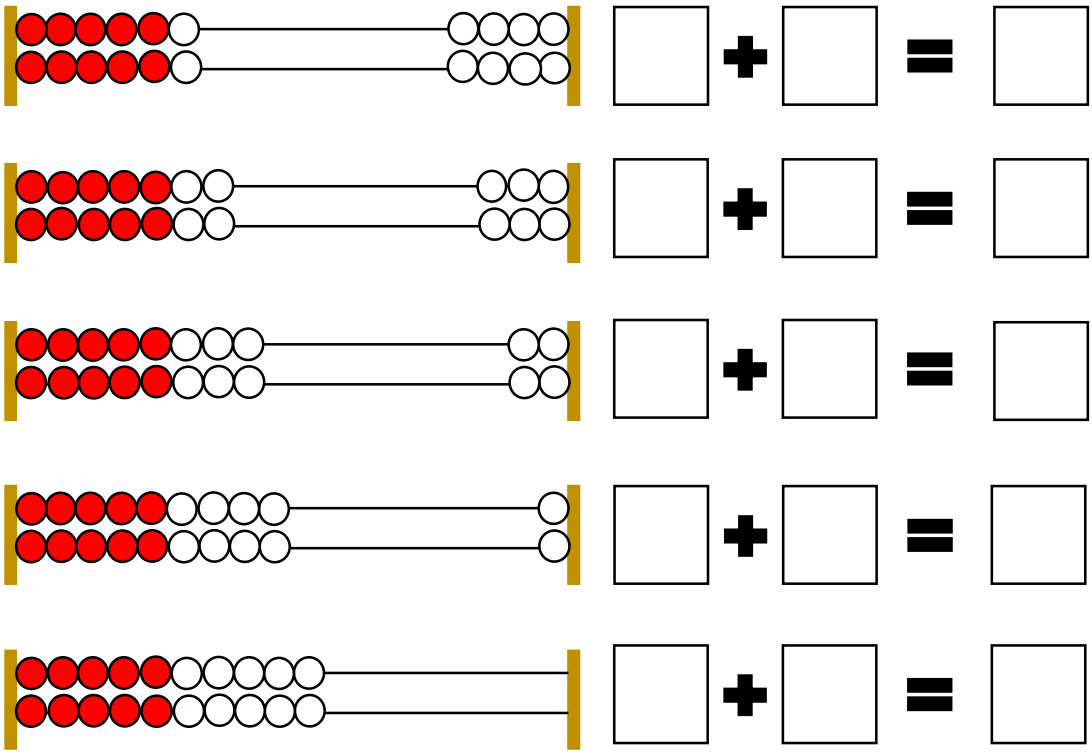

8+8=	4+4=	6+6=	2+2=
6+6=	9+9=	5+5=	10+10=
7+7=	2+2=	2+2=	7+7=
3+3=	5+5=	7+7=	5+5=
4+4=	4+4=	4+4=	8+8=
5+5=	10+10=	10+10 =	6+6=
6+6=	7+7=	8+8=	9+9=





Lisanne van den Belt

+ 2 sommen.

0+2=	4+2=	3+2=	9+2=
1+2 =	5+2=	5+2=	0+2=
2+2=	2+2=	2+2=	2+2=
7+2=	8+2=	7+2=	8+2=
4+2=	4+2=	4+2=	4+2=
5+2=	3+2=	10+2=	6+2=

Bedenk zelf rijtjes met + 2 sommen.

....+2=	....+2=
....+2=	....+2=
....+2=	....+2=
....+2=	....+2=

Kleur de + 2 sommen.

8+2	6+2	2+2	1+1	7+2
4+2	5+2	1+2	3+2	8+1

– 2 sommen.

8–2=	7–2=	3–2=	5–2=
3–2=	3–2=	5–2=	6–2=
4–2=	2–2=	7–2=	2–2=
9–2=	5–2=	5–2=	7–2=
6–2=	4–2=	10–2=	4–2=
5–2=	9–2=	2–2=	8–2=



Bedenk zelf rijtjes met – 2 sommen.

....–2=	....–2=
....–2=	....–2=
....–2=	....–2=
....–2=	....–2=

Kleur de – 2 sommen.

4–2	6–2	7–2	2–1	4–2
5–2	9–1	8–2	9–2	2–2

Verliefde harten!

10





2

8

9

1

6

0

3

3

2

7

4

8

10

0

Verliefde harten!

10

	1	
	8	
9	2	4
10	7	3
8	3	6
2	10	0

Lisanne van den Belt

Maak de sommen in de tabel.

5 som	−2 som	verdwijnsom	bijna verdwijnsom
5−1=	2−2=	1−1=	1−0=
5+5=	3−2=	2−2=	2−1=
7−5=	4−2=	3−3=	3−2=
7−2=	5−2=	4−4=	4−3=
8−5=	6−2=	5−5=	5−4=
8−3=	7−2=	6−6=	6−5=
3+2=	8−2=	7−7=	7−6=
5+3=	9−2=	8−8=	8−7=
4+5=	10−2=	9−9=	9−8=
5+3=		10−10=	10−9=



Kleur een ster geel als er een dubbelsom in staat.
en een ster rood als er een verliefde hartensom in staat.
Schrijf het antwoord in de ster!

3+3=	7+3=	2+2=	4+4=
4+6=	2+8=	5+5=	9+1=
6+4=	3+7=	10+0=	1+9=
1+1=	10+10=	8+2=	0+10=
5+5=	3+3=	2+8=	3+7=

Zoek het juiste antwoord bij de som, trek lijntjes.



5+5=	10
4+6=	18
10+8=	10
6+6=	10
3+7=	12

7+7=	10
2+8=	14
10+5=	16
8+8=	15
1+9=	10



Zoek het juiste antwoord bij de som, trek lijntjes.

9+9=	10
7+3=	18
10+9=	10
4+6=	19
9+1=	10

2+2=	10
2+8=	4
10+3=	16
8+8=	13
5+5=	10

Lisanne van den Belt

Zoek het juiste antwoord bij de som,
trek lijntjes.

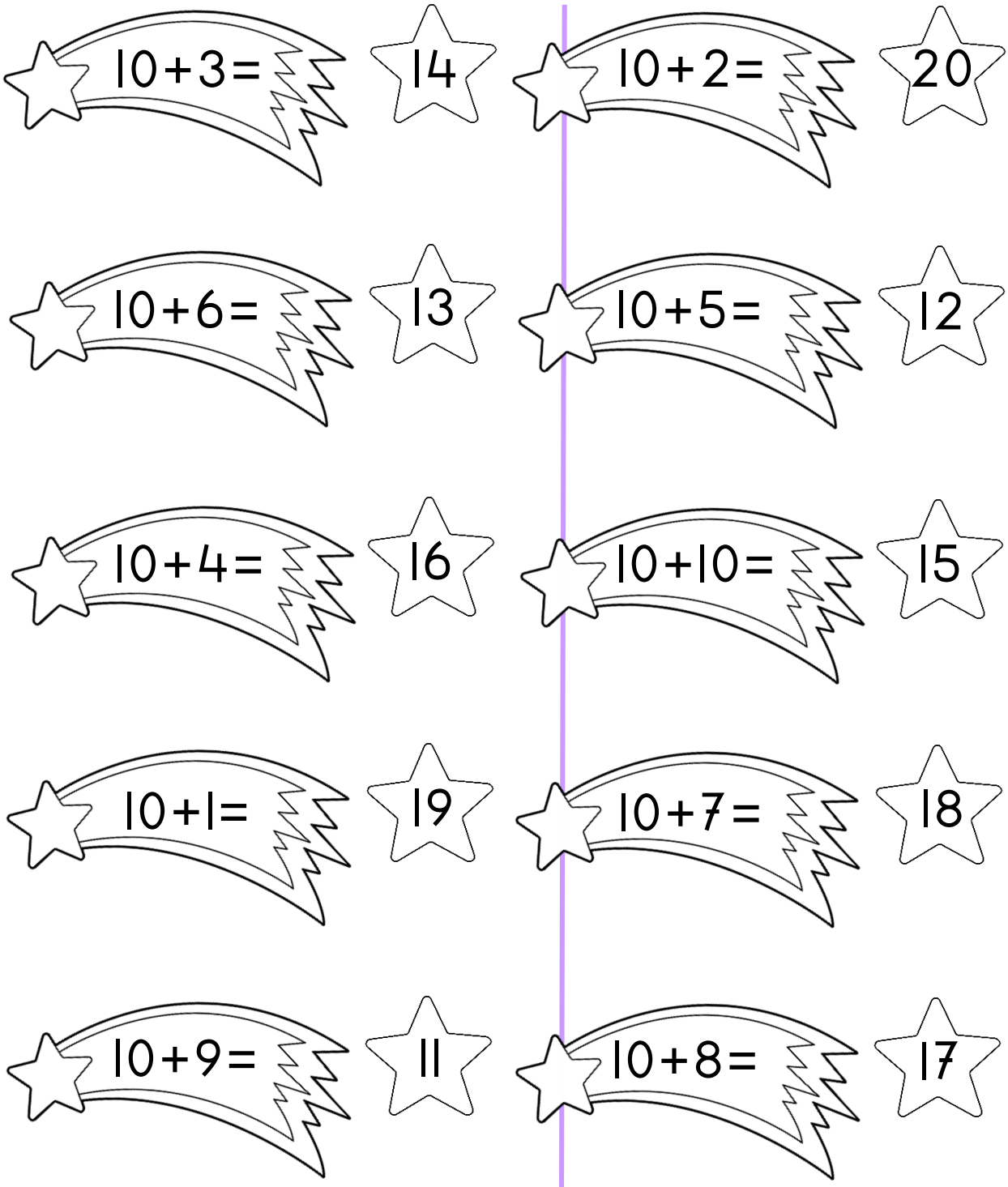

Splitsen van 10.



Splitsen van 10.



Splitsen van 10.

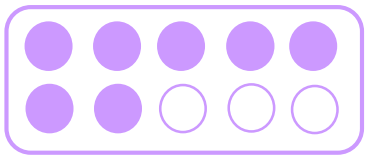

7+.....=10

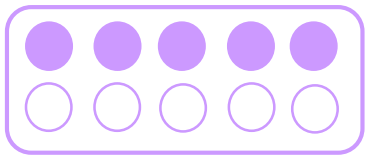

5+.....=10



8+.....=10

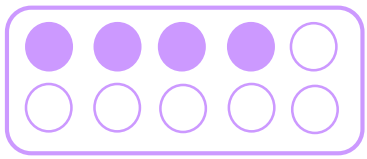

4+.....=10

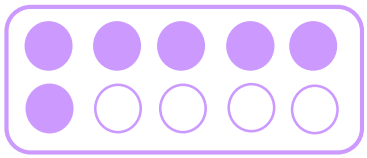

6+.....=10

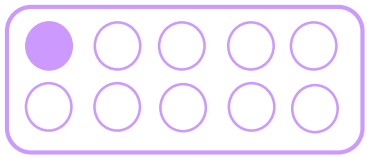

1+.....=10

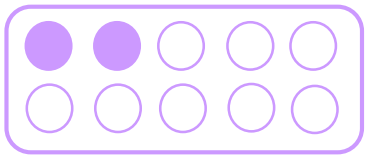

2+.....=10



9+.....=10

Kleur de som in. Gebruik hiervoor 2 kleuren.

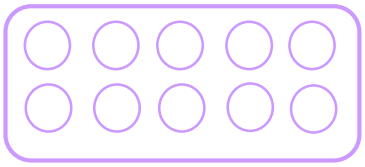

7+3=10

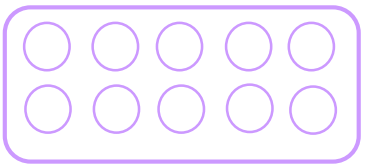

5+5=10

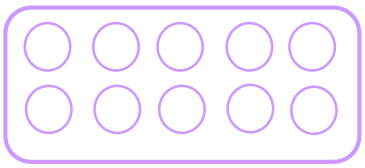

8+2=10

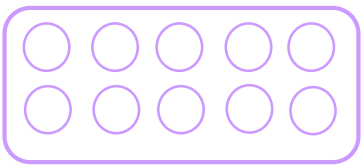

4+6=10

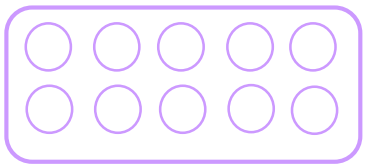

6+4=10

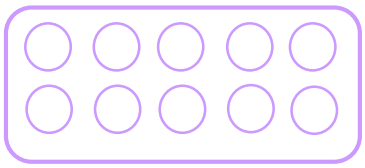

1+9=10

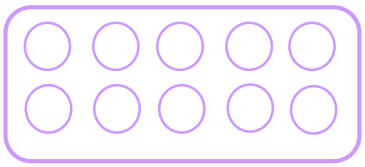

2+8=10

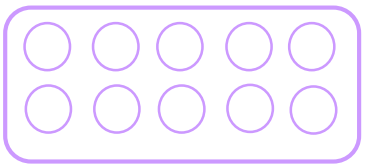

9+1=10

Maak samen 10.
Geef de getallen die samen 10 zijn, dezelfde kleur!
Denk aan de verliefde harten!

4	6	3	2	10	9	1	4	4	8
1	3	7	8	4	8	8	6	9	2
5	7	0	4	9	10	0	5	7	1
5	2	1	6	1	5	5	8	3	8
0	1	9	0	0	1	2	5	0	10
10	7	3	6	3	9	2	1	8	9
3	4	5	7	4	6	6	9	3	7
2	8	5	10	0	6	5	5	4	9

Maak samen 10.
Kleur de planeten in!





Maak samen 10.
Kleur de planeten in!





Maak samen 10.
Kleur de planeten in!





Maak samen 10.
Kleur de planeten in!





Hoeveel moet je betalen?
Maak het bedrag met zo min mogelijk munten en biljetten.



9 euro





4 euro



10 euro





8 euro



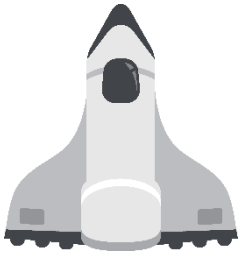

5 euro





6 euro



Hoeveel moet je betalen?
Maak het bedrag met zo min mogelijk munten en biljetten.

7 euro



9 euro



6 euro



10 euro



8 euro



5 euro



Splitsen!



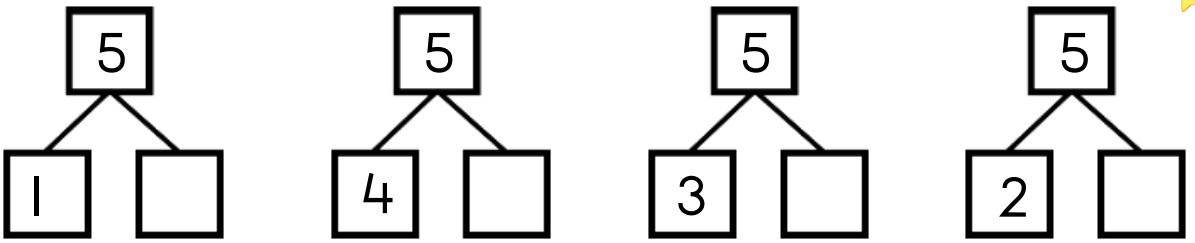

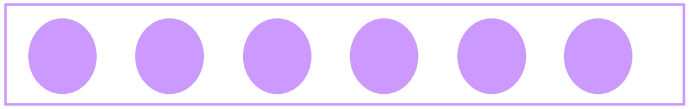

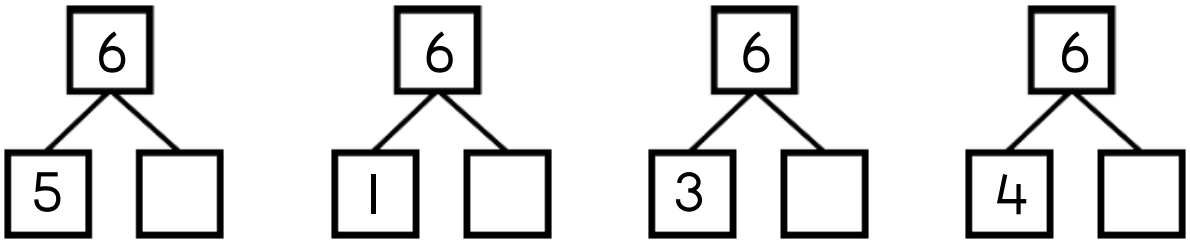



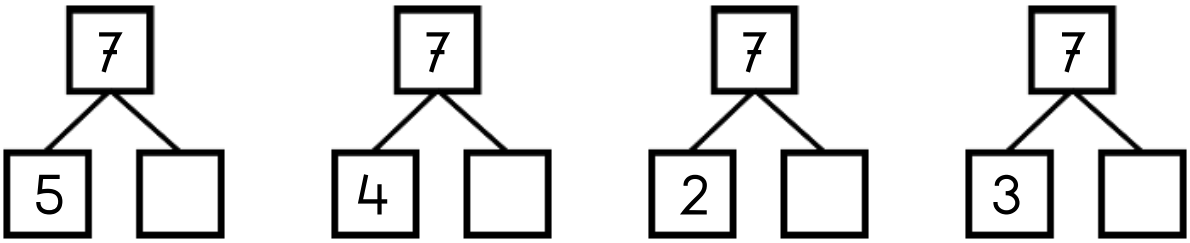

Splitsen!



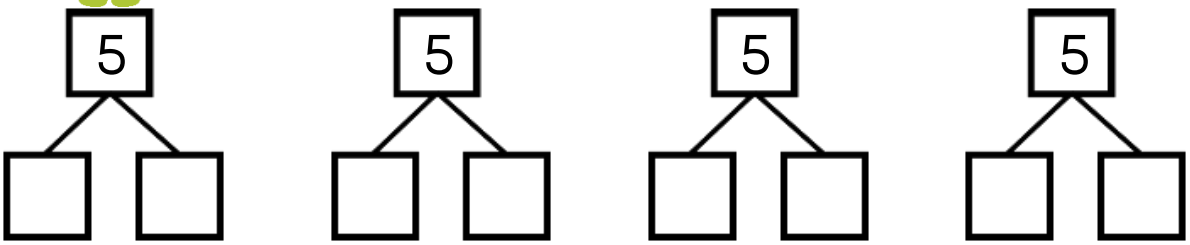

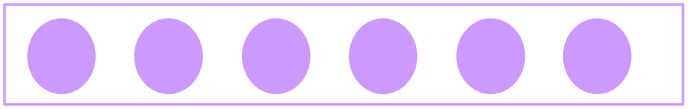

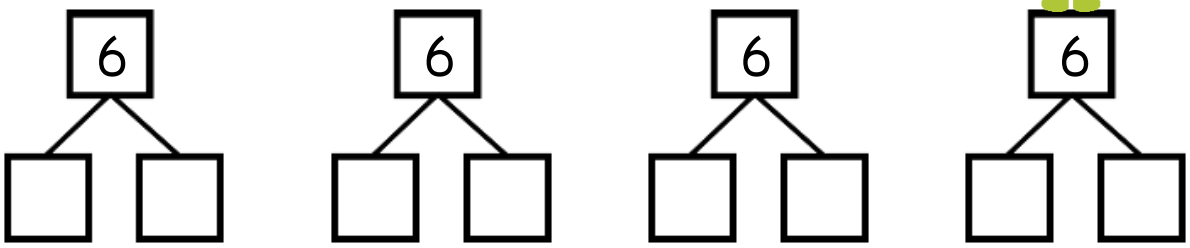



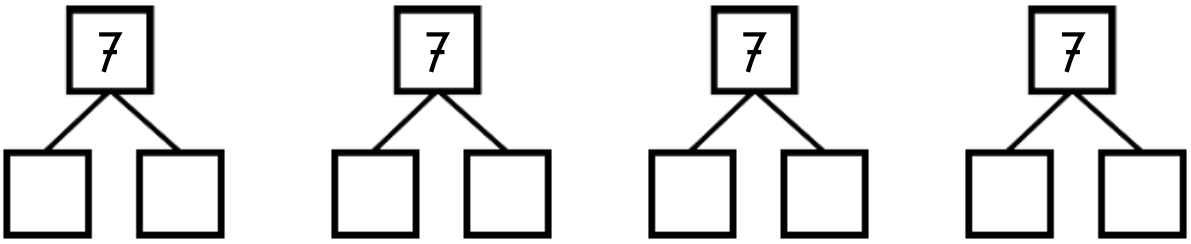

Lisanne van den Belt

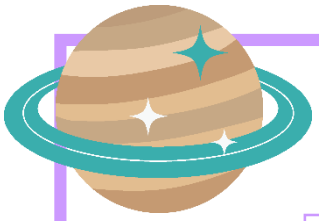

Splitsen!

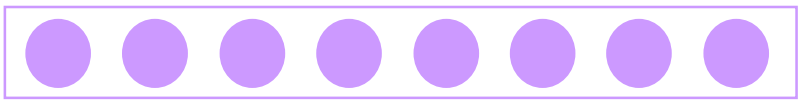

8 → 5 + ☐	8 → 0 + ☐	8 → 2 + ☐	8 → 6 + ☐
8 → 1 + ☐	8 → 3 + ☐	8 → 4 + ☐	8 → 7 + ☐





9 → 5 + ☐	9 → 2 + ☐	9 → 3 + ☐	9 → 4 + ☐
9 → 7 + ☐	9 → 1 + ☐	9 → 6 + ☐	9 → 0 + ☐

Splitsen!

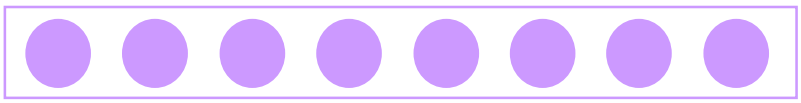

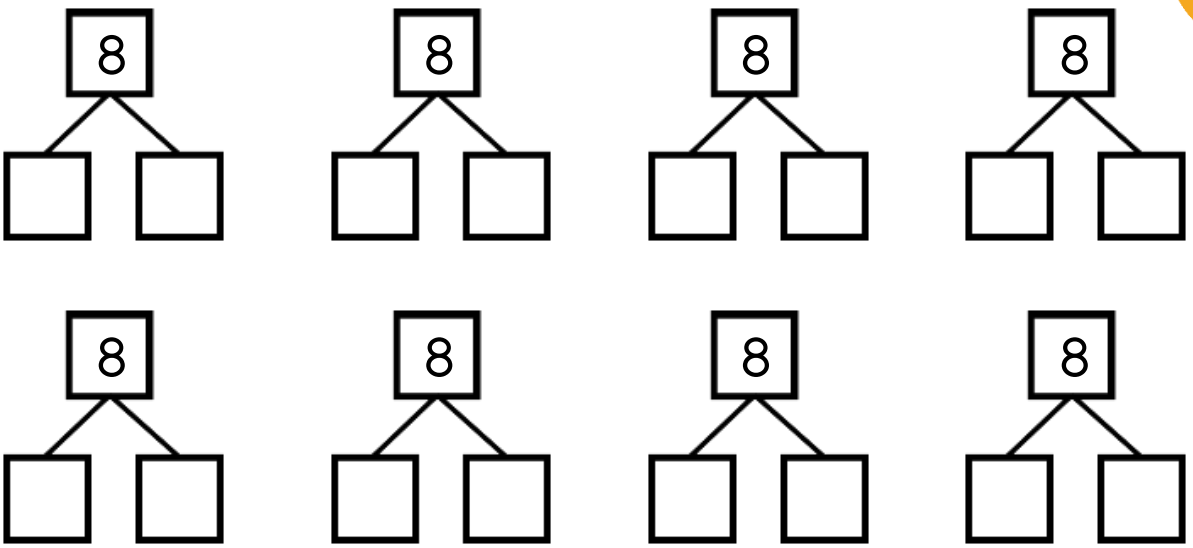



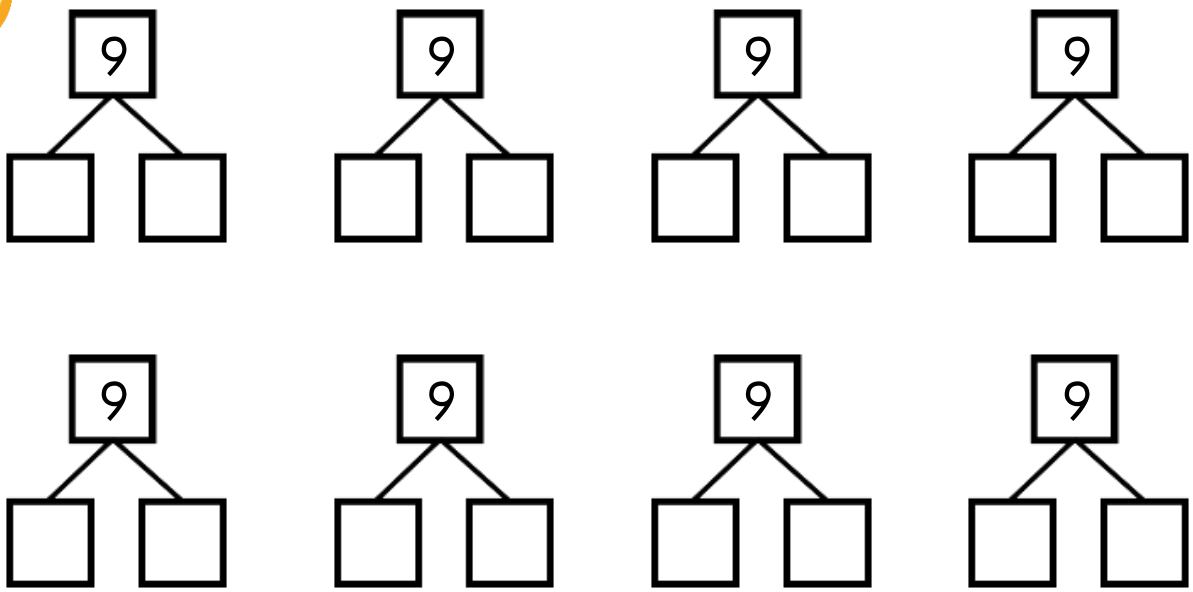

Splitsen!

start

5 = 1 + ☐	6 = 1 + ☐	7 = 1 + ☐	8 = 1 + ☐	9 = 1 + ☐	5 = 2 + ☐
6 = 3 + ☐	5 = 3 + ☐	9 = 2 + ☐	8 = 2 + ☐	7 = 2 + ☐	6 = 2 + ☐
7 = 3 + ☐					
8 = 3 + ☐	9 = 3 + ☐	5 = 4 + ☐	6 = 4 + ☐	7 = 4 + ☐	8 = 4 + ☐
					9 = 4 + ☐
5 = 0 + ☐	9 = 5 + ☐	8 = 5 + ☐	7 = 5 + ☐	6 = 5 + ☐	5 = 5 + ☐
6 = 6 + ☐					
7 = 6 + ☐	8 = 6 + ☐	9 = 6 + ☐	5 = 1 + ☐	6 = 1 + ☐	7 = 7 + ☐



einde

Splitsen!

start

10 – 1 – ☐

10 – 2 – ☐

10 – 3 – ☐

10 – 4 – ☐

10 – 5 – ☐

10 – 6 – ☐

10 – 2 – ☐

10 – 0 – ☐

10 – 10 – ☐

10 – 9 – ☐

10 – 8 – ☐

10 – 7 – ☐

10 – 3 – ☐

10 – 4 – ☐

10 – 1 – ☐

10 – 7 – ☐

10 – 6 – ☐

10 – 5 – ☐

10 – 8 – ☐

10 – 9 – ☐

10 – 0 – ☐

10 – 5 – ☐

10 – 5 – ☐

10 – 7 – ☐

10 – 0 – ☐

10 – 1 – ☐

10 – 6 – ☐

10 – 4 – ☐

10 – 2 – ☐

10 – 8 – ☐

10 – 1 – ☐

10 – 10 – ☐

10 – 7 – ☐

einde

Lisanne van den Belt

De raket gaat bijna vertrekken!
Zoek de juiste klok en trek een lijntje!

half 3

half 1

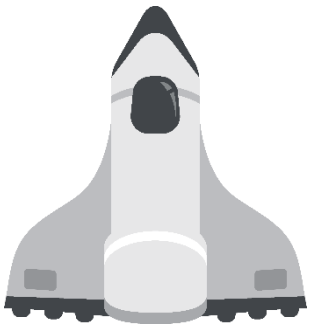

half 11

half 5

half 6

half 7













Lisanne van den Belt

De raket gaat bijna vertrekken!
Zoek de juiste klok en trek een lijntje!

half 4

half 12

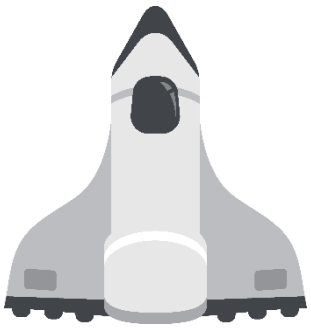

half 9

half 2

half 8

half 10













Lisanne van den Belt

Over een uur gaat de raket de ruimte in!
Hoe laat is het dan?



1 uur later





1 uur later





1 uur later





1 uur later



Over een uur gaat de raket de ruimte in!
Hoe laat is het dan?



1 uur later





1 uur later





1 uur later





1 uur later



We zijn sinds een uur weer op de aarde geland!
Hoe laat was het toen?



1 uur vroeger





1 uur vroeger





1 uur vroeger





1 uur vroeger



We zijn sinds een uur weer op de aarde geland!
Hoe laat was het toen?



1 uur vroeger





1 uur vroeger







1 uur vroeger





1 uur vroeger



Splitsspeurtocht

1.



Lisanne van den Belt

2.



Lisanne van den Belt

Splitsspeurtocht

3.



Lisanne van den Belt

4.



Lisanne van den Belt

5.



Lisanne van den Belt

6.



Lisanne van den Belt

7.

Lisanne van den Belt

8.



Lisanne van den Belt

Splitsspeurtocht

9.



Lisanne van den Belt

10.



Lisanne van den Belt

11.



Lisanne van den Belt

12.



Lisanne van den Belt

Splitsspeurtocht!

Hoeveel sterren zweven er achter de maan?

1.
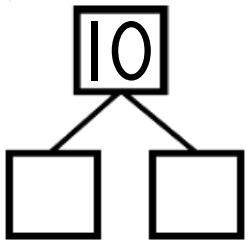

2.
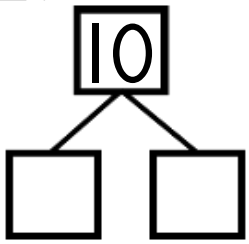

3.
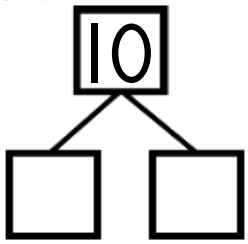

4.
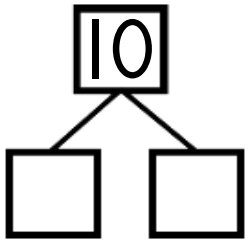

5.
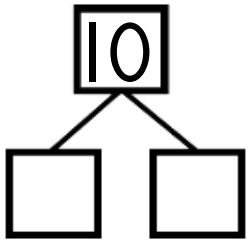

6.
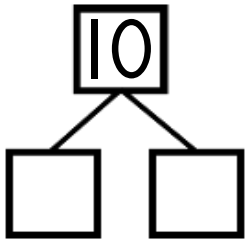

7.
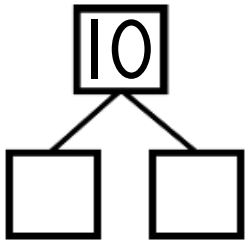

8.
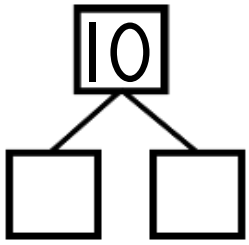

9.
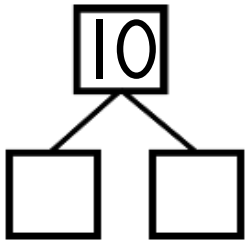

10.
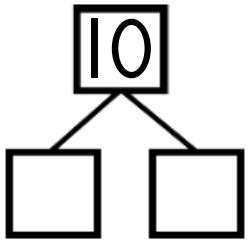

11.
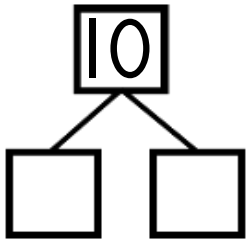

12.
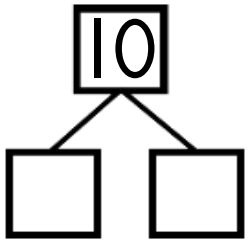

Splitsspeurtocht

1.



Lisanne van den Belt

2.



Lisanne van den Belt

Splitsspeurtocht

3.



Lisanne van den Belt

4.



Lisanne van den Belt

Splitsspeurtocht

5.



Lisanne van den Belt

6.



Lisanne van den Belt

Splitsspeurtocht

7.



Lisanne van den Belt

8.



Lisanne van den Belt

Splitsspeurtocht

9.



Lisanne van den Belt

10.



Lisanne van den Belt

Splitsspeurtocht

11.



Lisanne van den Belt

12.



Lisanne van den Belt

Splitsspeurtocht!

Hoeveel astronauten stappen er uit de raket?

1. 5

2. 6

3. 9

4. 10

5. 8

6. 10

7. 8

8. 7

9. 10

10. 10

11. 8

12. 10

Lisanne van den Belt